Lesson objective: Looking at properties of 2D Shapes.

Do now

In your workbooks draw a

Star

Triangle

Circle.

In your workbooks complete these sentences. The first one has been done for you.

	A circle has **1** Side and **0** corners.
	
	A rectangle has___sides and___corners.
	A square has ____sides and corners.
	An oval has ____side and_____corners
	A triangle has __sides and____corners.